Nome:_____ **nº:**_____ **T.**_____ **Data:**_____

6.3.4a Adição e Subtração de Partes do Todo

1. Pinte as frações abaixo conforme o comando e calcule:

a) Dois quartos mais um quarto.

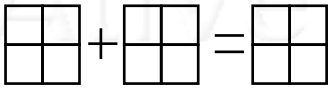

b) Cinco sextos menos três sextos.

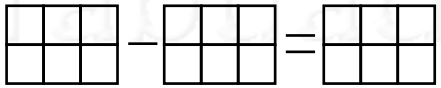

c) Oito nonos menos cinco nonos.

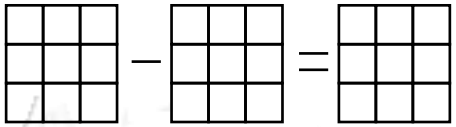

d) Um sétimo mais cinco sétimos.

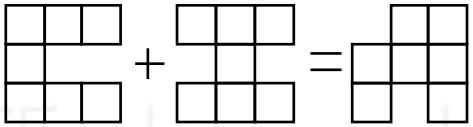

e) Três oitavos mais dois oitavos.

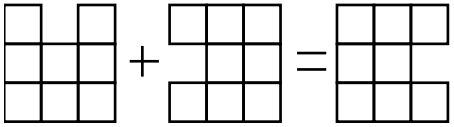

f) Cinco quintos menos três quintos.

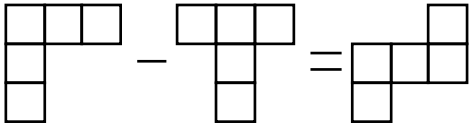

g) Dois nonos mais quatro nonos.

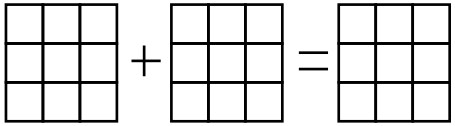

h) Três terços mais dois terços.

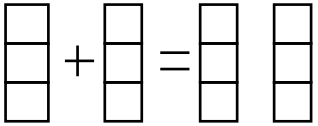

Nome:_____ **nº:**_____ **T.**_____ **Data:**_____

6.3.4a Adição e Subtração de Partes do Todo

1. Pinte as frações abaixo conforme o comando e calcule:

a) Dois quartos mais um quarto.

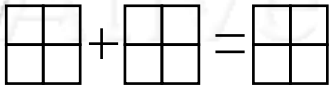

b) Cinco sextos menos três sextos.

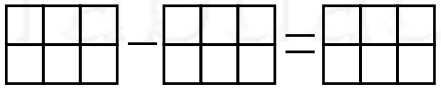

c) Oito nonos menos cinco nonos.

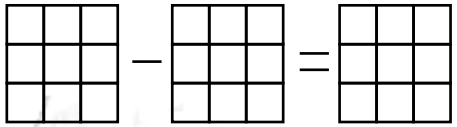

d) Um sétimo mais cinco sétimos.



e) Três oitavos mais dois oitavos.

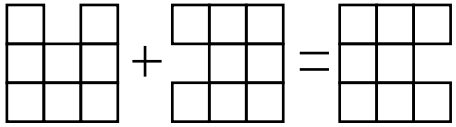

f) Cinco quintos menos três quintos.

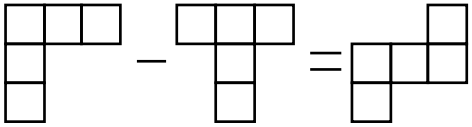

e) Dois nonos mais quatro nonos.

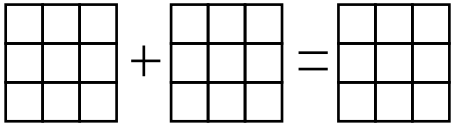

f) Três terços mais dois terços.

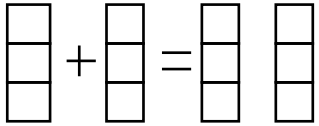

www.ativeatabuada.com.br